1º Primaria – Tercer trimestre

Publicado en El Sonido de la hierba al crecer

Autor pictogramas: Sergio Palao **Procedencia:** http://catedu.es/arasaac/ **Licencia:** CC (BY-NC-SA)
Ilustraciones de internet
Autora: María Olmos López

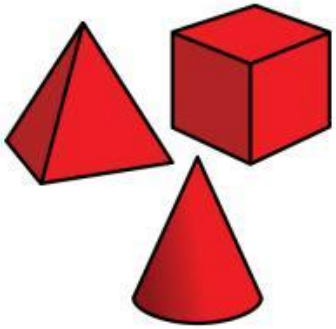

Las figuras

Tema 11. Las figuras

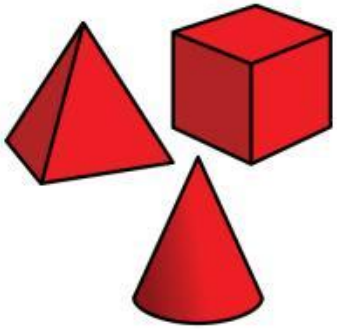

Las figuras

y

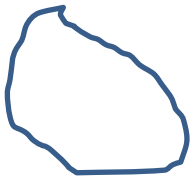

Líneas abiertas y líneas cerradas

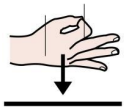

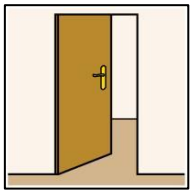

Estas líneas son abiertas

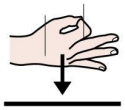

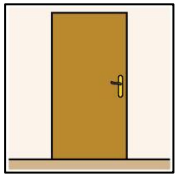

Estas líneas son cerradas



Yo me oriento

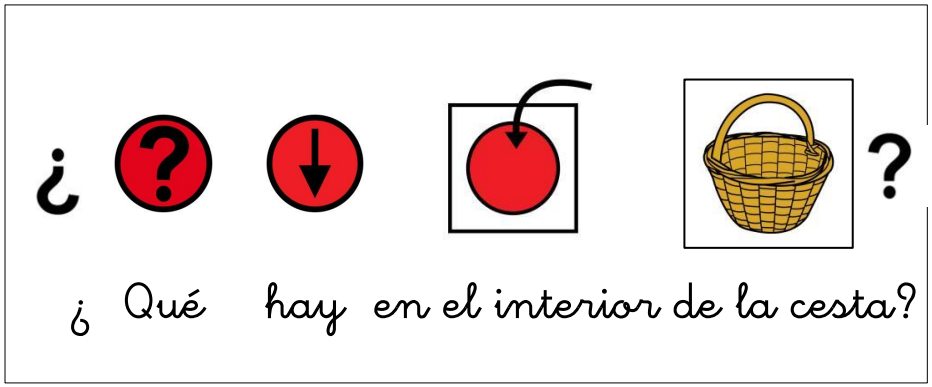
¿ ?
¿ Qué hay en el interior de la cesta?

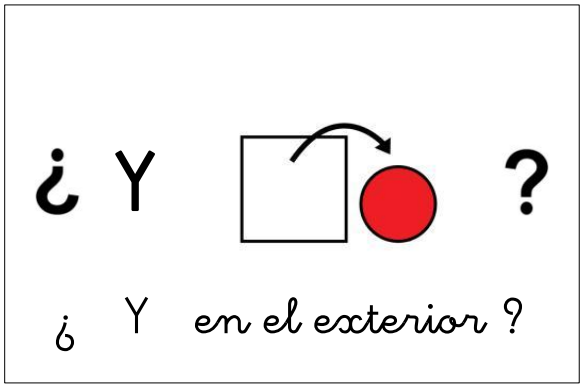
¿ Y ?
¿ Y en el exterior ?



En el interior de la cesta hay manzanas



En el exterior de la cesta hay un melón

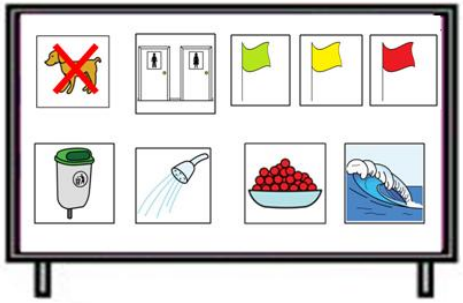



El cartel de la playa

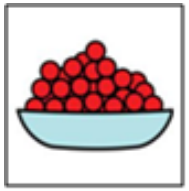

En la playa hay muchas olas

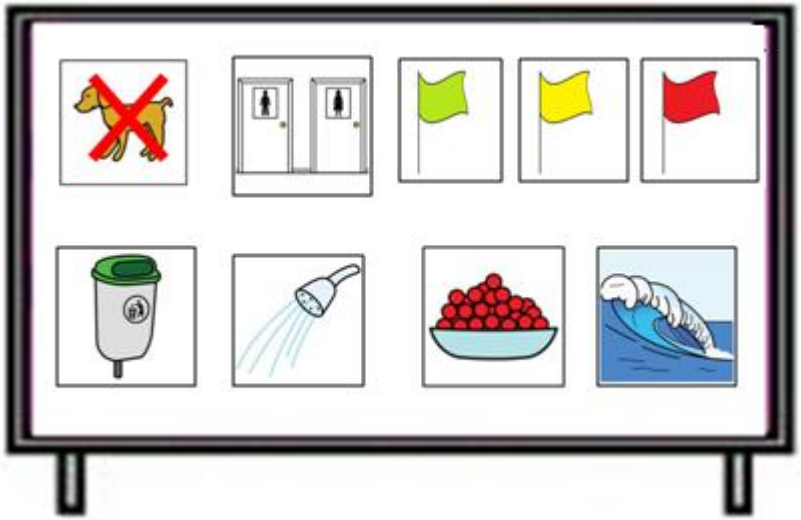



Actividades



¿A quién se dirige este cartel ? Rodea.

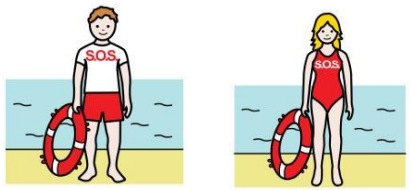

A los socorristas



A los bañistas

A los pescadores

¿ ? .

¿ Qué hay en la playa ? Rodea

Duchas

Papelera

Lavadora

Aseos

Primeros auxilios

Horno

Zona para perros

Columpios

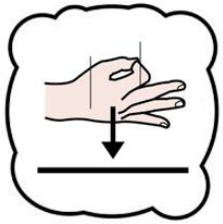



El significado de las banderas en la playa

Mar tranquilo

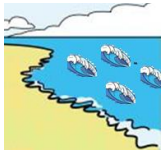

Precaución

Peligro

¿ 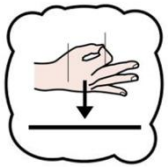 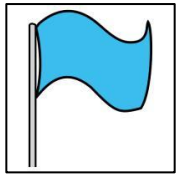 ?

.

¿ Qué significa cada bandera? Relaciona.



Cuidado al bañarse

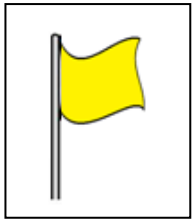

Prohibido bañarse

Permitido bañarse

Pueblo y ciudad

Tema 12. Pueblo y ciudad

La vivienda

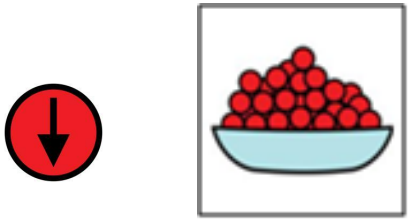

Hay muchos tipos de viviendas en el mundo



Actividades



Piso



Chalet

Casa

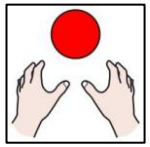

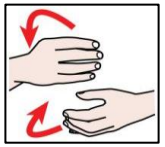

Las viviendas pueden estar hechas con



ramas

hielo

ladrillos

telas



Actividades

¿De qué están hechas estas viviendas? Une con flechas.

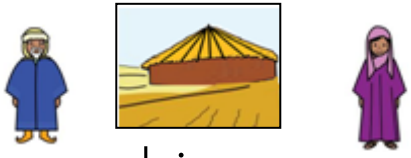

Jaima

Hielo



Piso

Ladrillos

Iglú

Telas

¿ 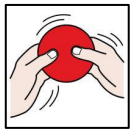 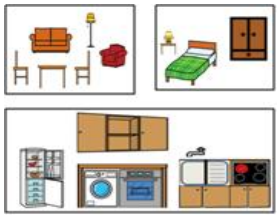 ?

.

¿Para que se usan estas habitaciones de la casa? Relaciona.



Cocinar

Ver la tele

Dormir

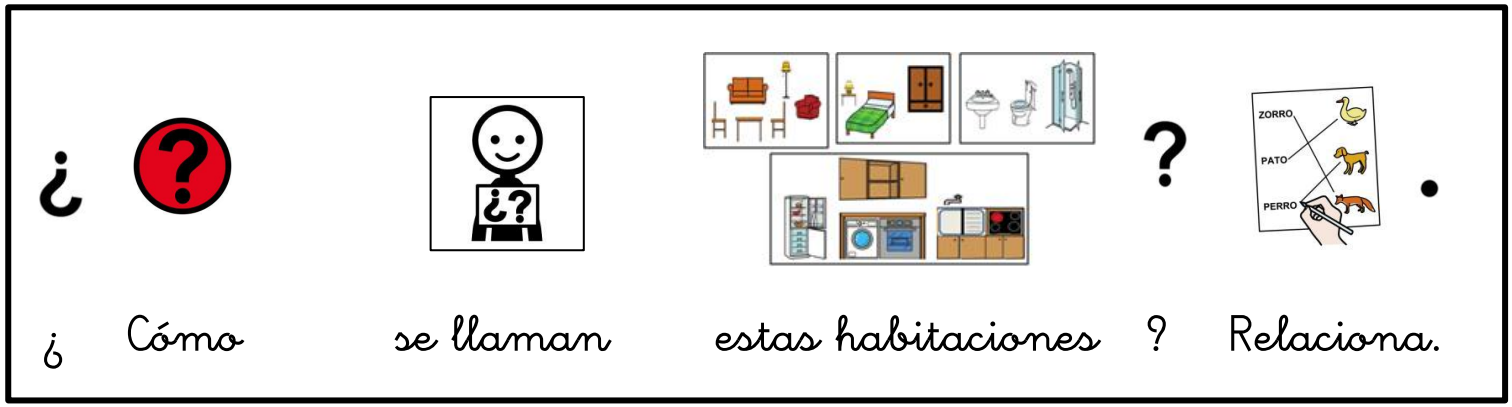

Dormitorio | Salón | Cuarto de baño | Cocina

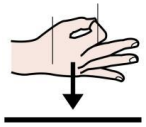

Una vivienda es un lugar para que vivan las personas

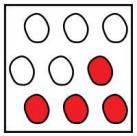

La vivienda tiene varias habitaciones

y

La calle y el barrio



En las calles

hay

Señales de tráfico

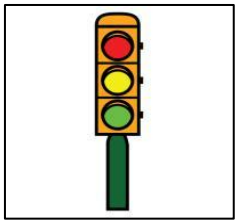

Semáforos

Parada de autobús

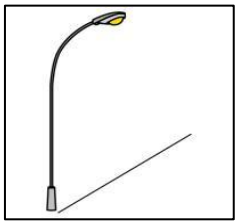

Farolas



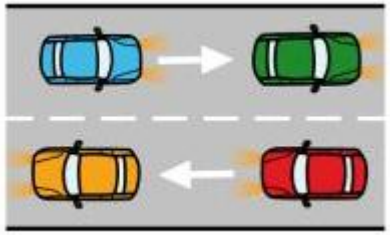

y

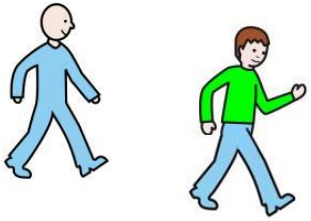

Por las calles circulan los vehículos y caminan las personas

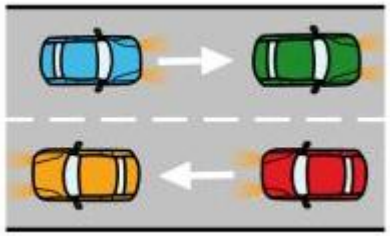

Los vehículos circulan

por la carretera



Las personas caminan



por la acera


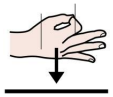

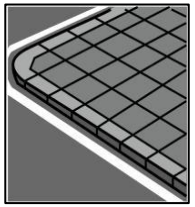
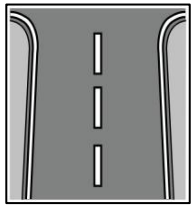

Las calles son vías con acera y calzada

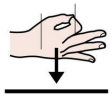





Un barrio es el conjunto de calles, plazas y edificios

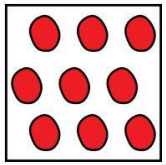
Todas


las calles

tienen

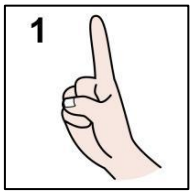

un

nombre


Todos


los edificios

tienen

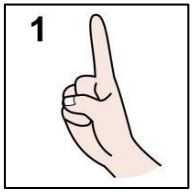

un

número

¿ Para qué sirve esta información ?

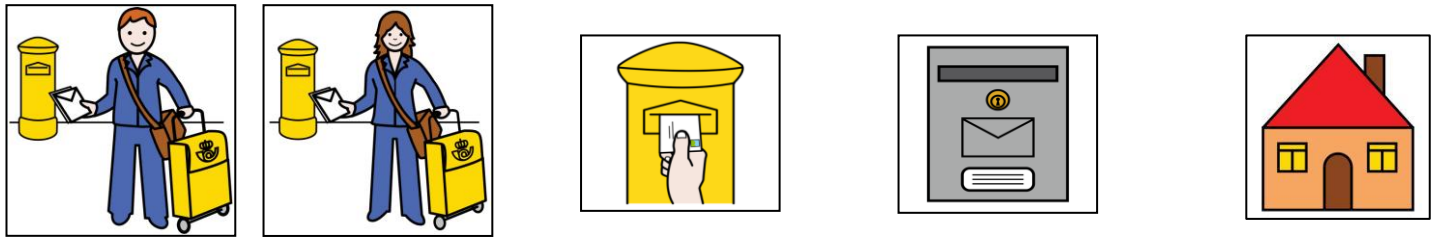

Para que el cartero eche las cartas en los buzones de las viviendas



Actividades



¿ Dónde están ? Señala el número en el lugar correcto

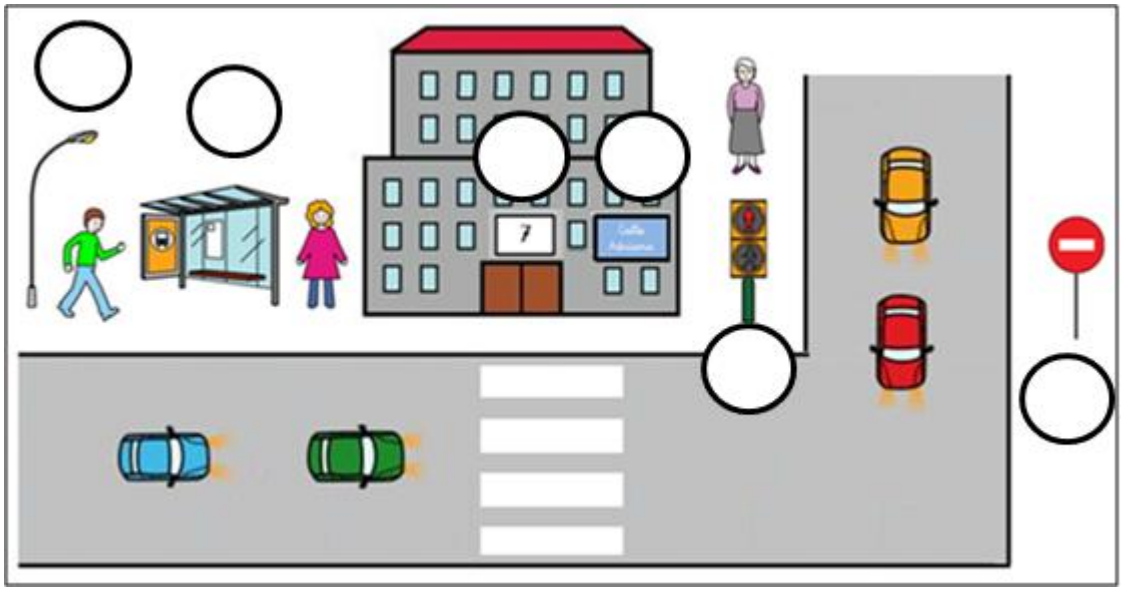

1. Señal de tráfico
2. Farola
3. Parada de autobús
4. Semáforo
5. Nombre de la calle
6. Número de portal

¿  ? .

¿ Qué hacen estas personas en el mercado de su barrio ? Rodea.

Comprar

Lavar ropa

Mirar productos

Vender

La localidad

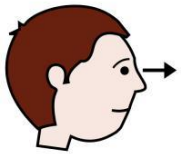

Observa

2

estas dos

imágenes

Pueblo

Ciudad

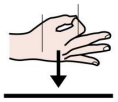

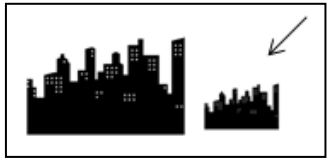

Los pueblos son localidades pequeñas con

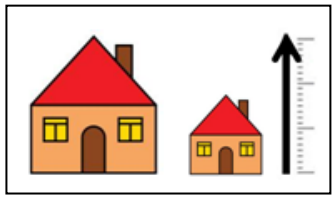

casas bajas

y

y

calles estrechas y cortas

Las ciudades

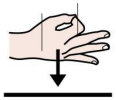

son

localidades



grandes con



edificios

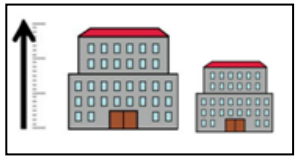

altos

calles

anchas

y

calles

largas

Las localidades tienen un Ayuntamiento donde trabajan



el alcalde o la alcaldesa

y

los concejales

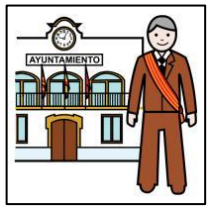

y



El alcalde o la alcaldesa y los concejales dirigen la localidad

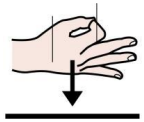

Mi localidad se llama Algeciras y es una ciudad

Vivir

en un pueblo

y

vivir

en una ciudad

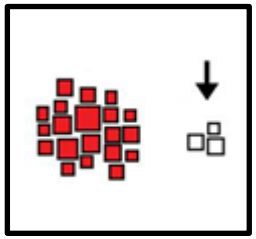

En los pueblos | hay | menos | habitantes

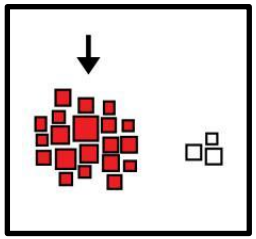

En las ciudades | hay | más | habitantes

2



Hay dos tipos de localidades

Pueblo

y

Ciudad

Ganadería, pesca, agricultura y minería

Tema 13. Ganadería, pesca, agricultura y minería

Ganadería y pesca

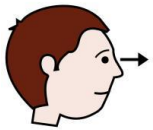

Mira estas imágenes

Ordeñar



Alimentar



Esquilar





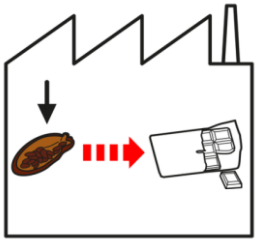

Estas personas trabajan para obtener materias primas de:



Vaca

Leche



Gallina

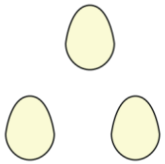

Huevos



Oveja

Lana



y



Estas personas obtienen peces y otros animales de

ríos

y del

mar



Actividades

¿  ? .

¿ Qué utilizan estas personas para atraparlos? Rodea.

Cañas de pescar

Un botella

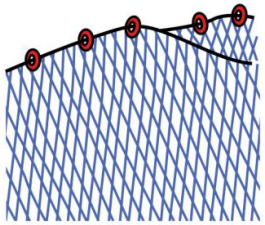

Redes

¿Quiénes

realizan



estas tareas ?

Relaciona.

Pastor

Granjera

Pescador



Ganadero

¿ Qué hacen los pescadores ? Rodea.



Esquilan las ovejas

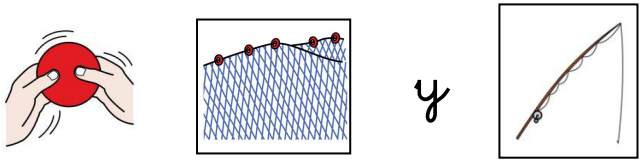

Utilizan redes y cañas



Ordeñan vacas, ovejas y cabras

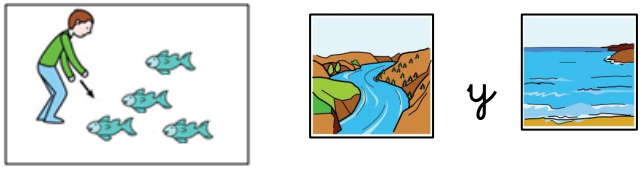

Capturan peces en ríos y mar

La ganadería

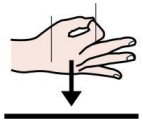

es

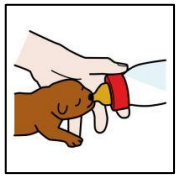

la cría



de animales

para obtener

alimentos

y



materiales

y

La pesca nos proporciona animales que hay en ríos y mares

Agricultura y minería

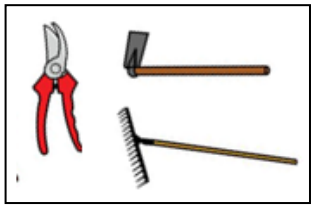
y


Los agricultores y hortelanos utilizan herramientas y maquinarias

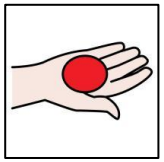

para obtener

productos

de la tierra

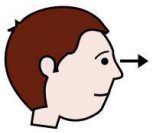

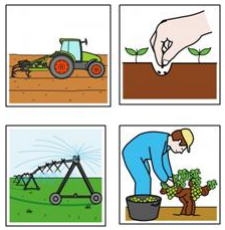

Mira estas imágenes

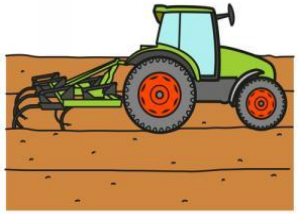

1º Arar

2º Sembrar



3º Regar

4º Cosechar

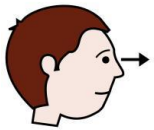

Mira

estas imágenes

1º Picar

2º Extraer

Los agricultores



aran,



siembran,

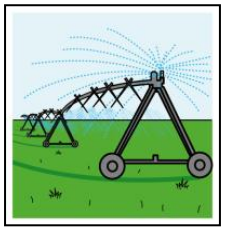

riegan

y

cosechan

frutas

verduras

y

hortalizas

Los mineros

pican

y

extraen



carbón

y



minerales



Actividades

¿ 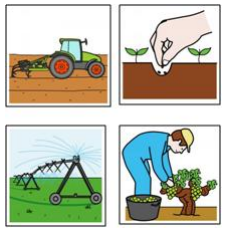 ? .

¿ Con qué trabajan los agricultores ? Rodea.

Azada

Tractor

Cosechadora

Pala

Rastrillo

Pico

¿ Qué utilizan los mineros ? Rodea.

Azada

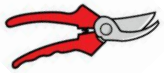

Tijeras de podar

Casco

Pala

Rastrillo

Pico

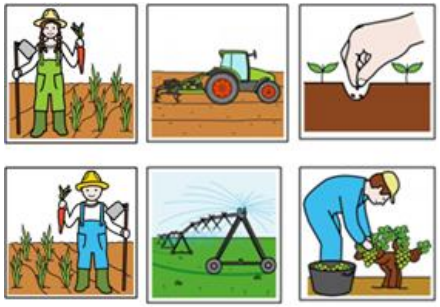

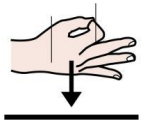

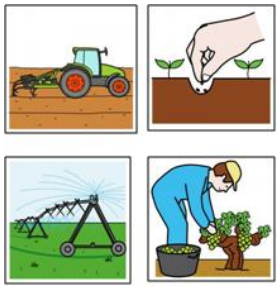

y

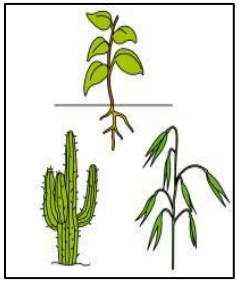

La agricultura consiste en cultivar la tierra y las plantas para obtener

alimentos

y

materiales

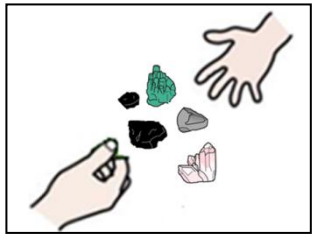

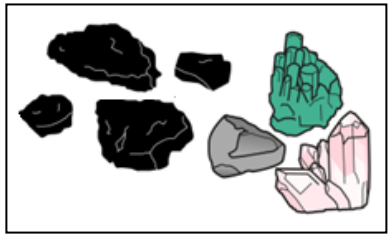

La minería nos proporciona rocas y minerales



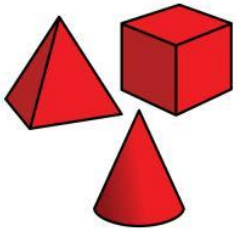

Conozco las figuras



Conozco

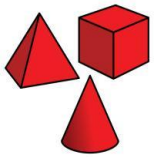

las figuras.

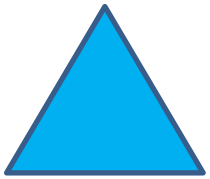

Los polígonos

¿ Cómo se llaman estas figuras ?

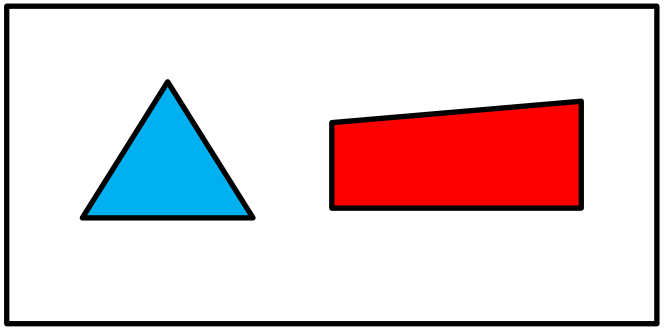

Polígonos

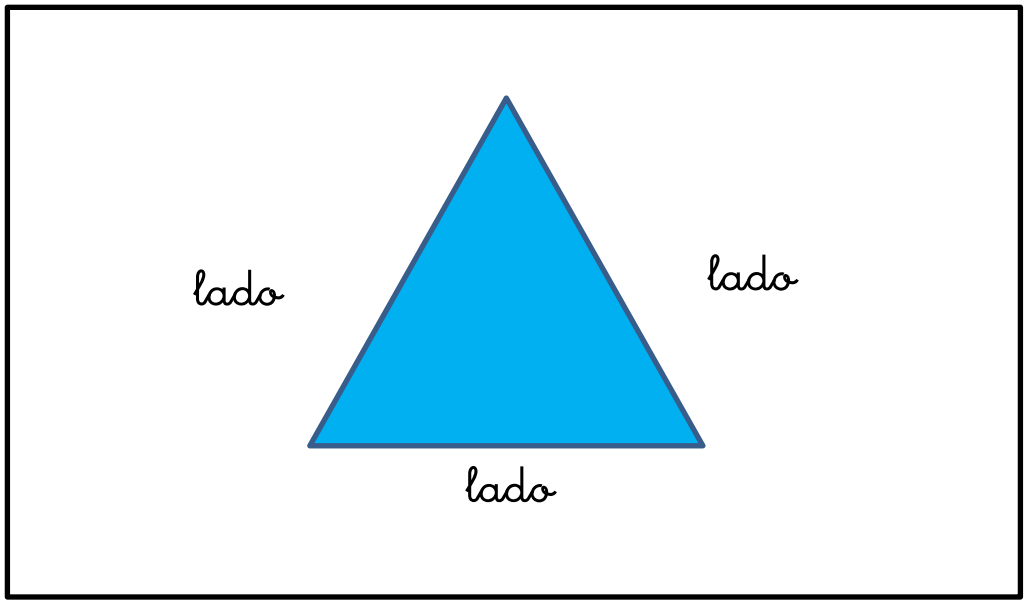
lado
lado
lado

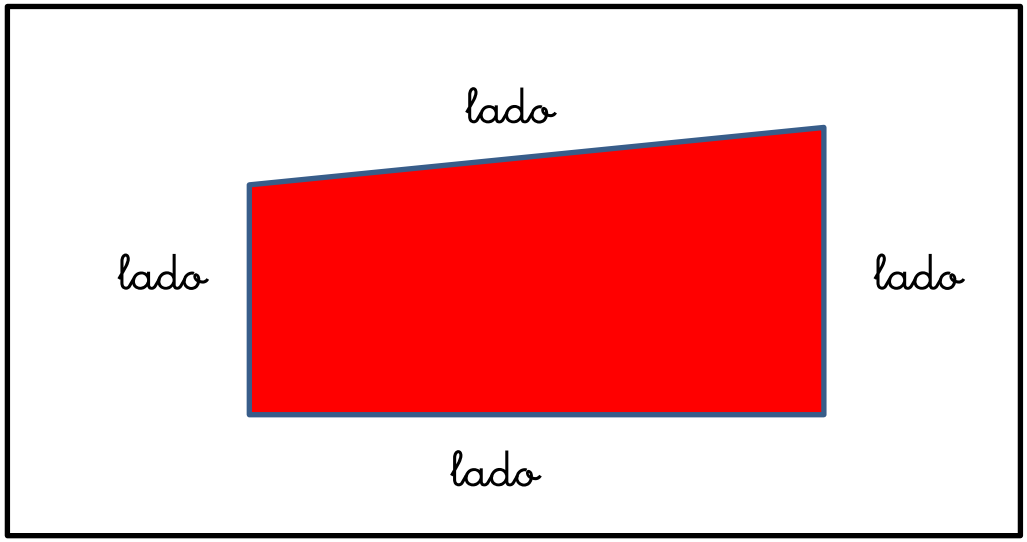
lado
lado
lado
lado

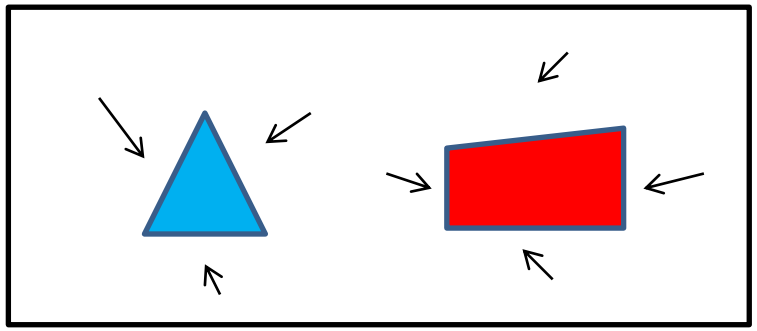

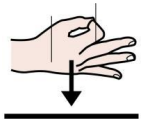

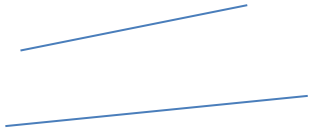

Los lados de los polígonos son líneas rectas

La línea

que forma

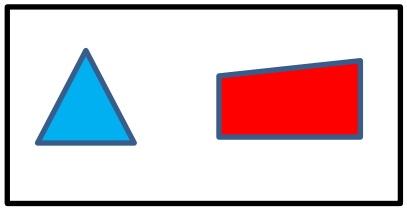

el polígono

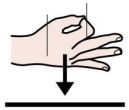

es

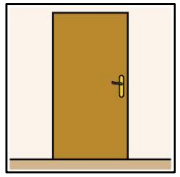

cerrada



Actividades

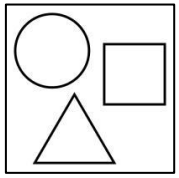

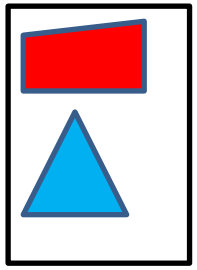

Rodea las señales con forma de polígono



Conozco

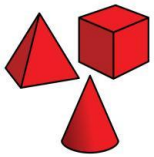

las figuras.



Los cuadriláteros

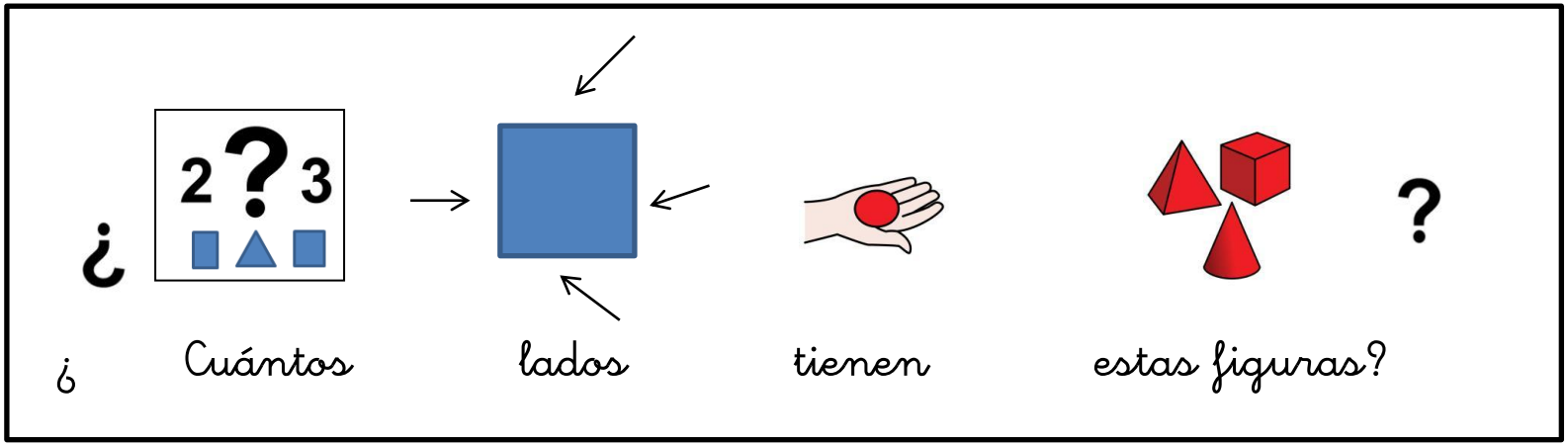
¿
2 ? 3
¿ Cuántos lados tienen estas figuras?

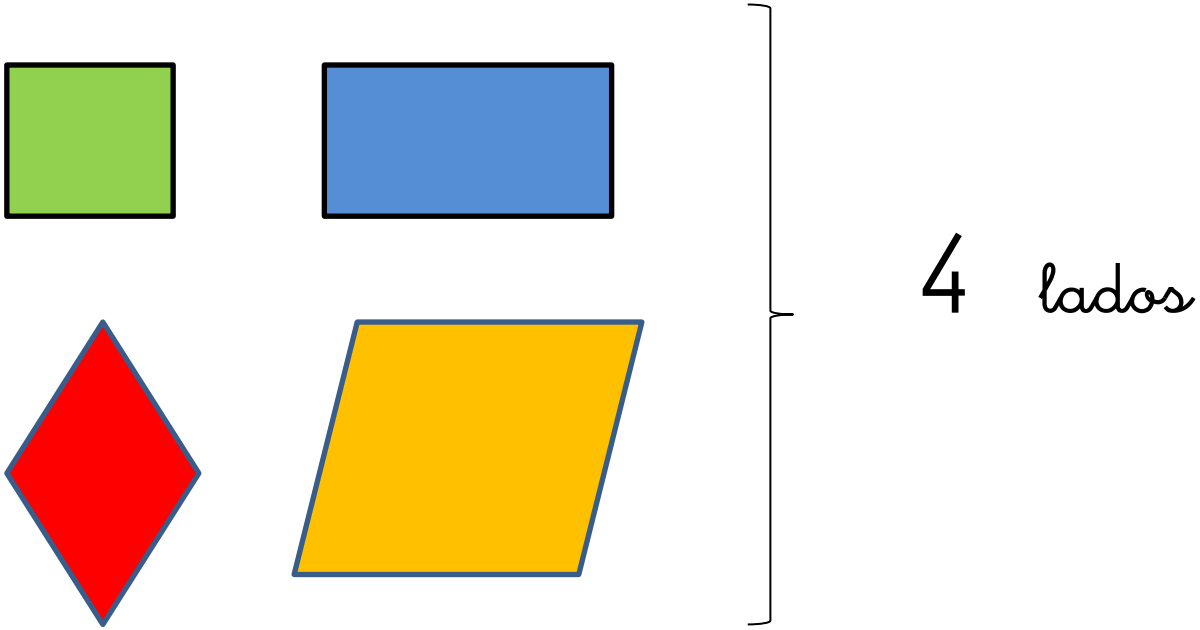
4 lados



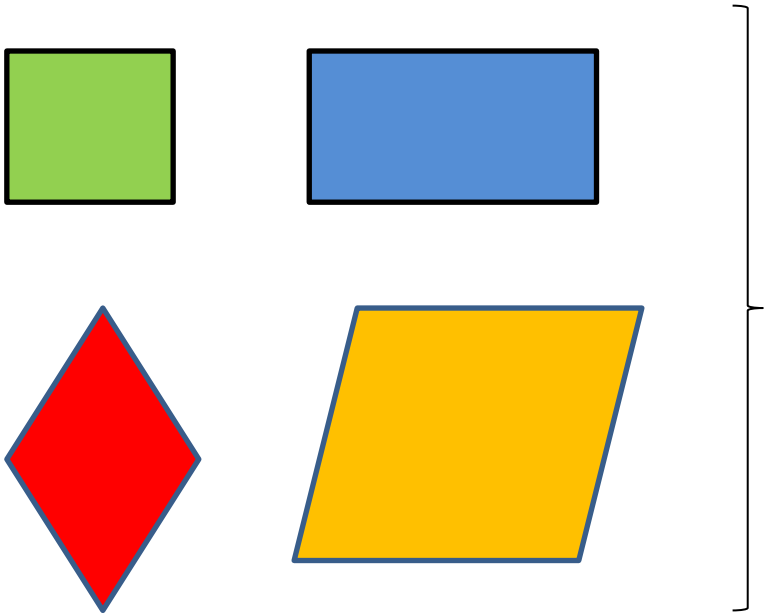

Cuadriláteros

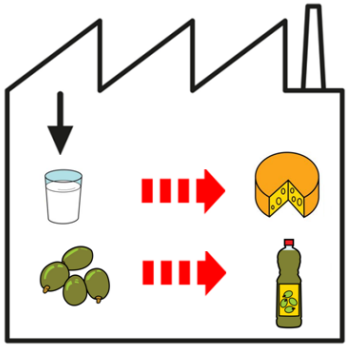

Las materias primas

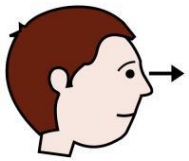



Observa estas imágenes

Uva

Algodón

Leche

¿ 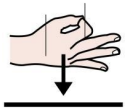  ?

¿ De dónde proceden estas materias?

Uva

Vid

Algodón

Algodón

Leche



Vaca

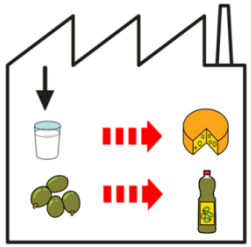

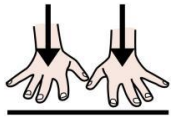

Las materias primas están en la naturaleza

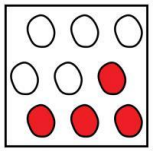
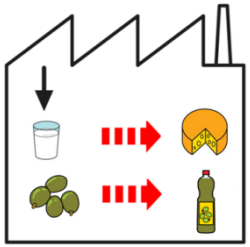

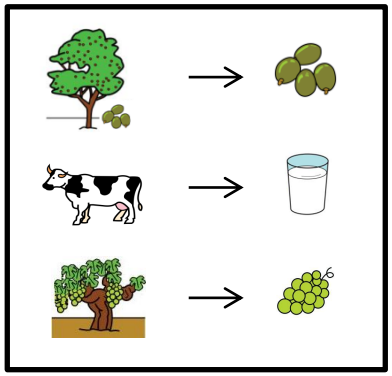

Algunas materias primas se usan sin transformar

y

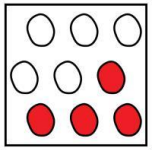
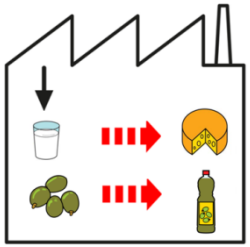



y algunas materias primas se usan transformadas



Actividades

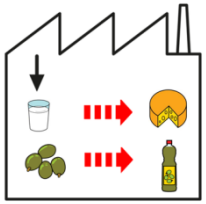

Rodea las materias primas



Pescado

Queso

Leche

Sandía

Lana

Mesa

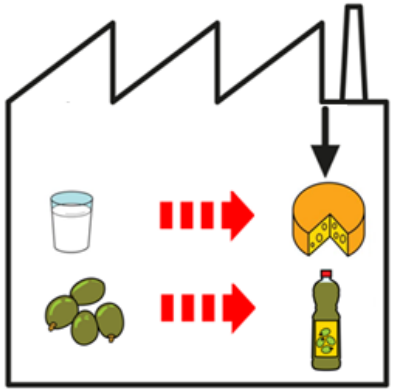

Los productos elaborados

Tema 14. Los productos elaborados

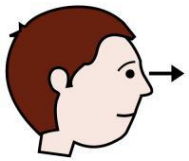



Observa estas imágenes

Ordeñar

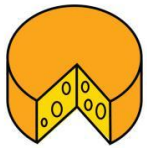

Queso

Mimbre

Cesta

Cortar madera



Muebles

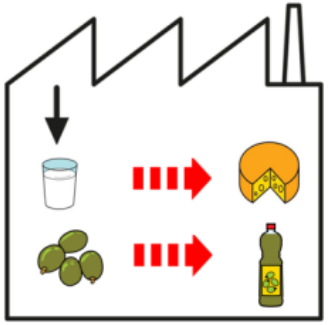

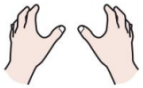



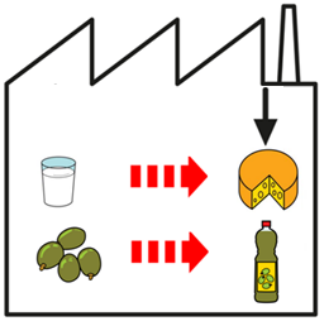

Las materias primas se pueden transformar en productos elaborados



Actividades



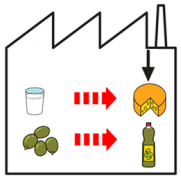

Une los productos elaborados con sus materias primas

Pan

Leche

Estantería

Trigo

Helado

Árbol

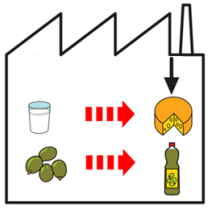

Rodea los productos elaborados

Mueble

Miel

Tronco

Lana

Jersey

Melocotón





Une los productos que obtenemos con sus materias primas

Con las uvas hacemos

Con el trigo hacemos

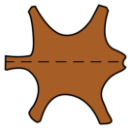

Con el cuero hacemos

Bolsos y zapatos

Vino

Pan

Las monedas

Los euros

Un euro

Dos euros

Los céntimos

50 céntimos

20 céntimos

10 céntimos

5 céntimos

2 céntimos

1 céntimo

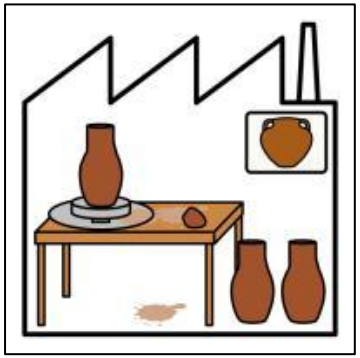

y



Talleres y fábricas

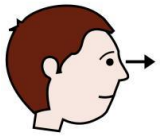



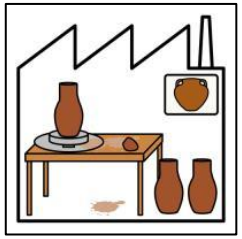



Observa estos lugares



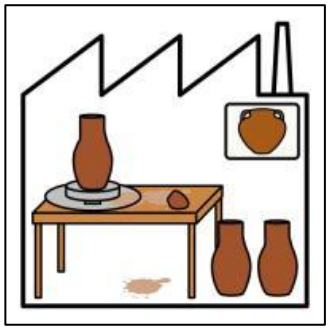

Taller



Fábrica


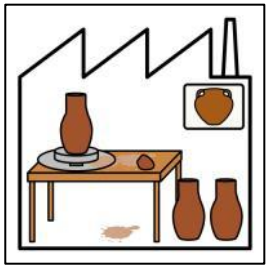

Los talleres

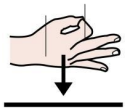

son



pequeños



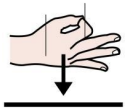



Las fábricas son grandes

Los artesanos



trabajan

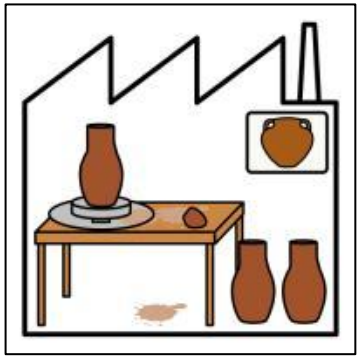

en el taller

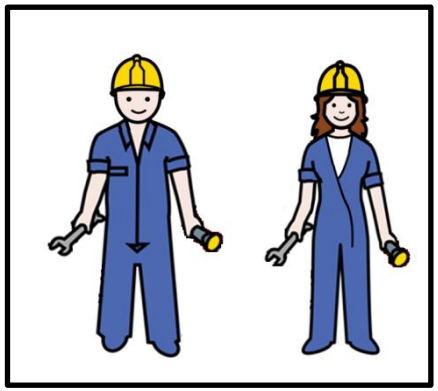

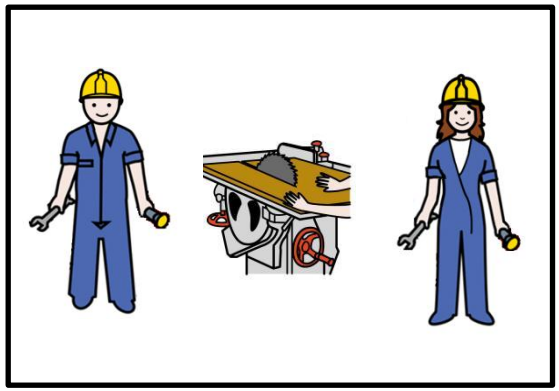



Los operarios trabajan en la fábrica

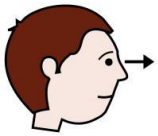

Observa



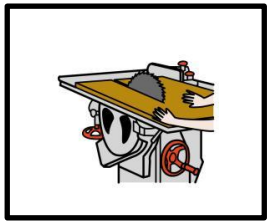

estas imágenes

Herramientas



Máquinas

Los artesanos



trabajan

con herramientas



Los operarios

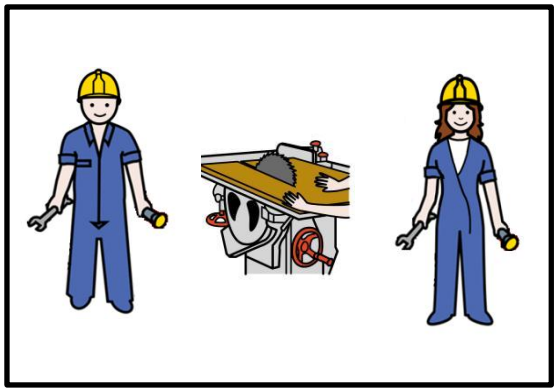

trabajan

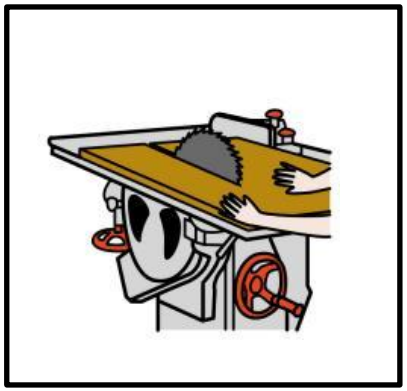

con máquinas

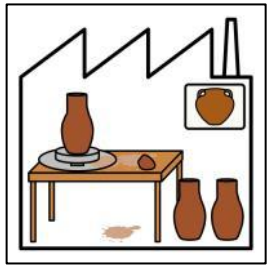

En el taller

los artesanos

hacen

Botijos

Cestas

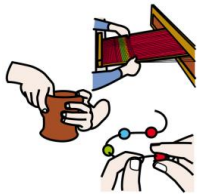

Artesanía



En la fábrica



los operarios

hacen

Barcos



Papel

Coches



Actividades

¿  ? 

¿ Dónde se elaboran estos productos ? Une con flechas.



Fábrica



Taller

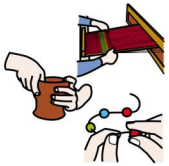

Artesanía



Papel

Coche

Barco

Cesta

Botijo



y



En los talleres y en las fábricas



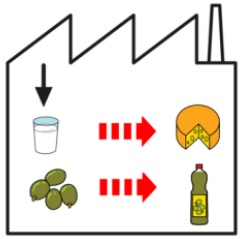

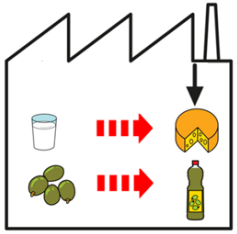

se transforman las materias primas en productos elaborados



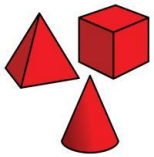

Conozco las figuras



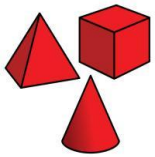







Conozco las figuras. El cilindro, el cono, la esfera

¿ Cómo se llaman estas figuras?



Cuerpos redondos



Actividades



Une

cada objeto

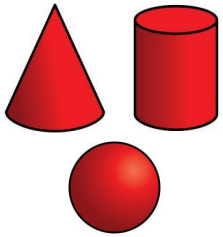

con su forma



Esfera



Cilindro



Cono

La seguridad en el trabajo

En el trabajo hay que protegerse para evitar accidentes

Hay que cumplir las medidas de seguridad en el trabajo

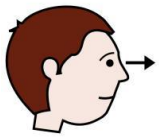



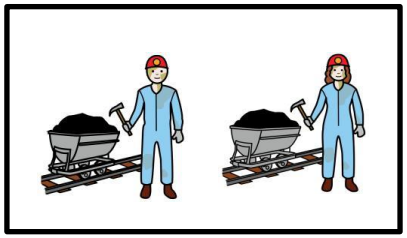

Observa estas imágenes

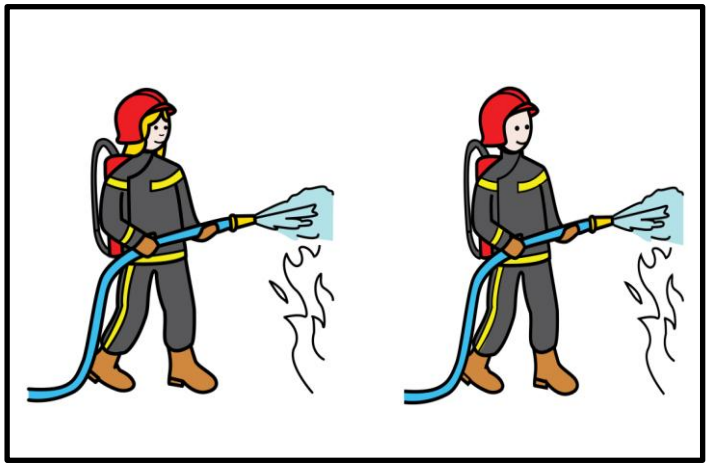



Los bomberos se protegen del fuego con:

Máscara

Guantes



Mono

Casco

Los mineros se protegen con:

Máscara

Guantes



Mono

Casco

¿

?

¿ Cómo se protege el soldador ?

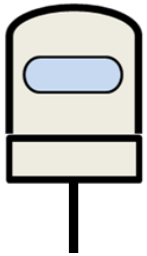

Con máscara

guantes



mono

y casco

El leñador

se protege

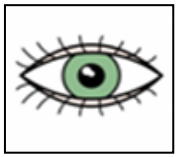

los ojos

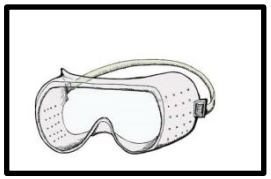

con gafas,

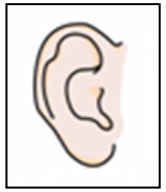

las orejas

con orejeras

para el ruido

y

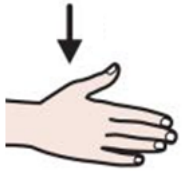

y las manos

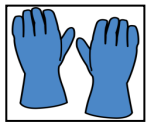

con guantes

Los servicios

Tema 15. Los servicios



Conozco los servicios

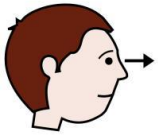

Observa

estas imágenes

Vendedora

Médica

Algunos trabajos se ocupan del

cuidado de la localidad

y

ayudar a sus habitantes

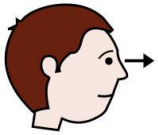



Observa estas profesiones

Jardinero

Policía

Bibliotecaria

¿



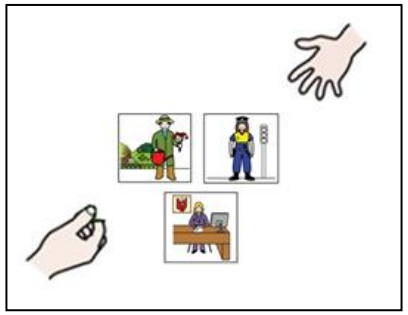

?

¿ Qué servicios ofrecen estas personas?

El jardinero

planta

flores

y

y

corta

el césped



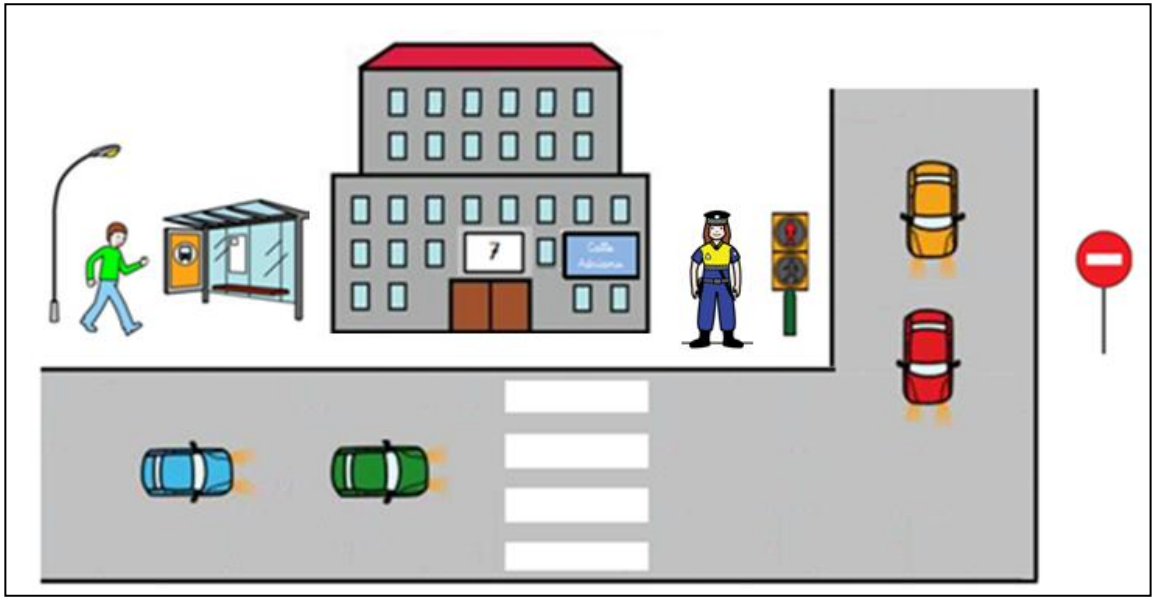

La policía ordenan el tráfico de las calles

La bibliotecaria

pide silencio

para leer

en la biblioteca


¿
?
.
¿Cuál es el trabajo de estas personas ? Une con flechas.


Bombero

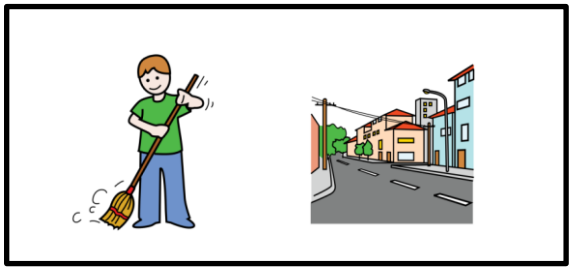


Barrendero




Profesora



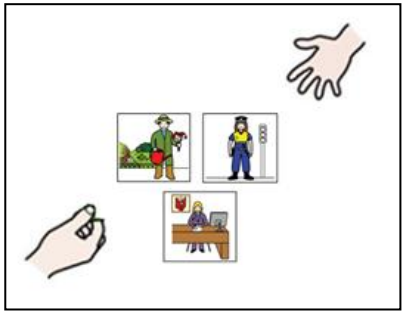

Hay trabajos que ofrecen servicios a la localidad



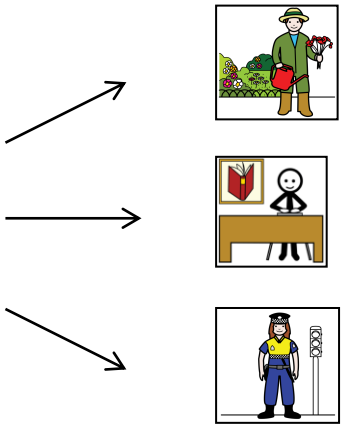

El Ayuntamiento se encarga de organizar algunos servicios



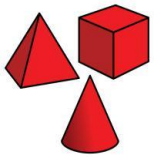

Conozco las figuras



Conozco

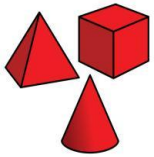

las figuras.

Los prismas

y



el cubo

¿ Cómo se llaman estos prismas?

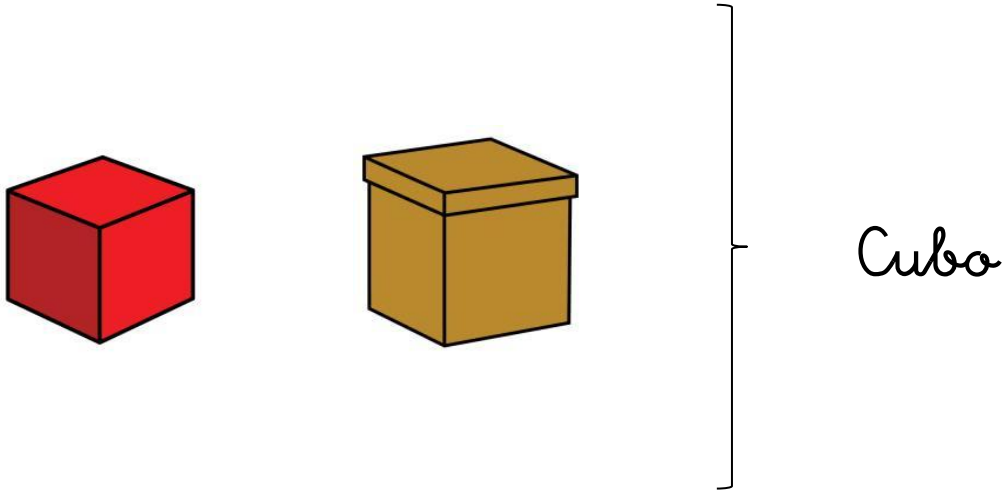

Cubo

Rodea



los objetos



con forma de cubo

Aro



Vela

Cubo

Cuaderno

Caja

Señal

Dado

Cubo



Conozco

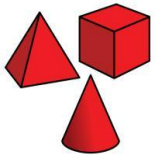

las figuras.



La pirámide

¿ Cómo se llaman estas figuras?





Pirámide







Rodea los objetos con forma de pirámide



Pirámide de Egipto

Pieza

Regalo

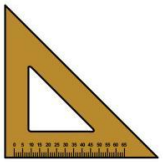

Regla



Cono

Pirámide de México

Los medios de transporte

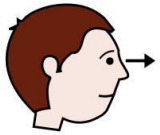



Observa estas imágenes

Camión

Barco

Avión

Tren

Autobús

Coche

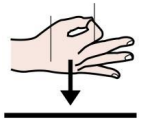

Son

medios de transporte

Camión tráiler

Barco

Avión

Tren

Autobús

Coche

Los medios de trasporte

llevan

personas

y



mercancías

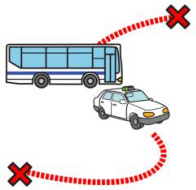

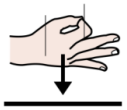

Los transportes de personas son:

avión

helicóptero

tren

autobús

taxi

moto

barco



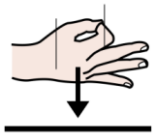

Los transportes de mercancías son:

avión

tren

camión

furgoneta

tráiler



barco

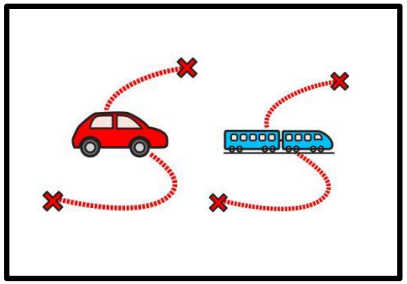

Los medios de transporte terrestres pueden utilizar

carreteras

y

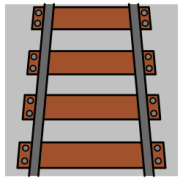

vías

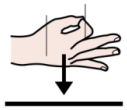

Los transportes que usan carreteras son:

camión

furgoneta

autobús

coche

taxi

moto

tráiler

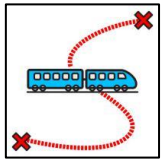

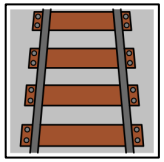
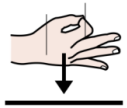

Los transportes que usan vías son:

tren

metro

tranvía

El transporte marítimo navega por

mares

ríos

lagos

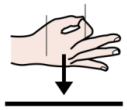

Los transportes marítimos son:

barco

yate

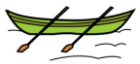

barca

canoa

lancha

hidropedal

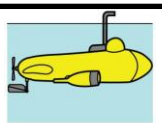

submarino



El transporte aéreo se mueve por el aire

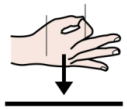

Los transportes aéreos son:

avión

helicóptero

avioneta

globo

cohete

Las normas

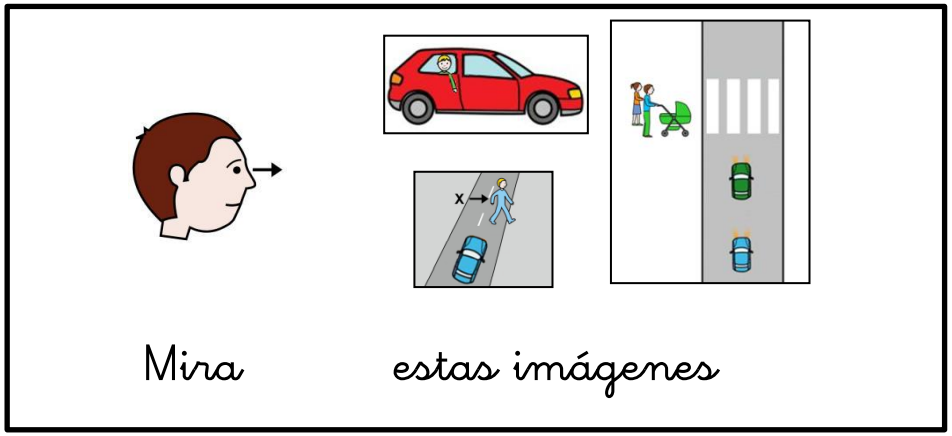
Mira
estas imágenes



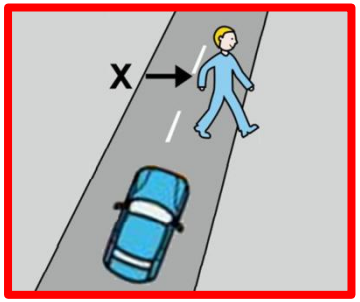
X

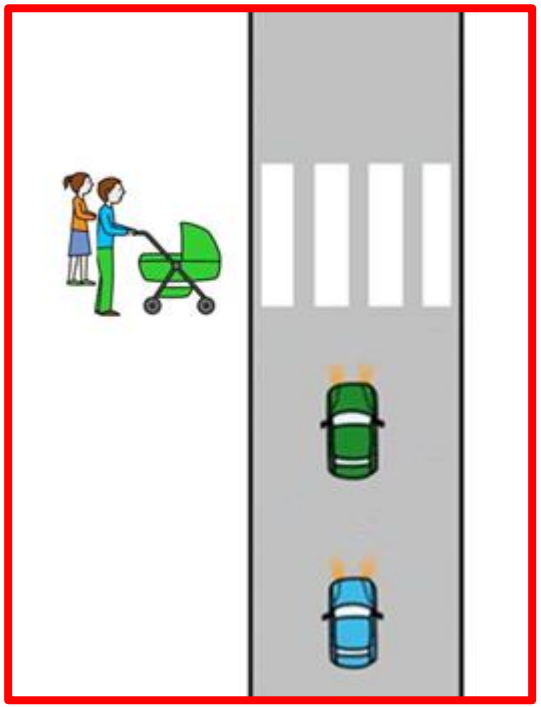

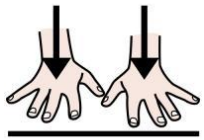

Está mal

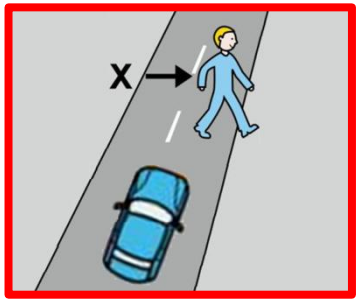

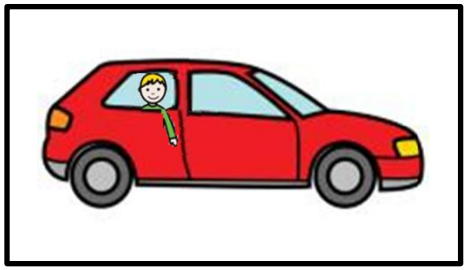

Prohibido sacar la mano y la cabeza

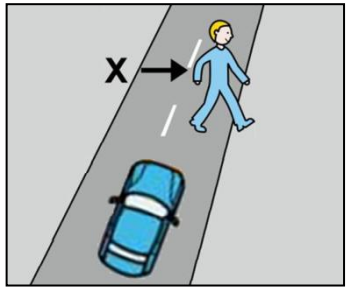

Se cruza por el paso de peatones

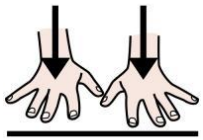

Está

bien

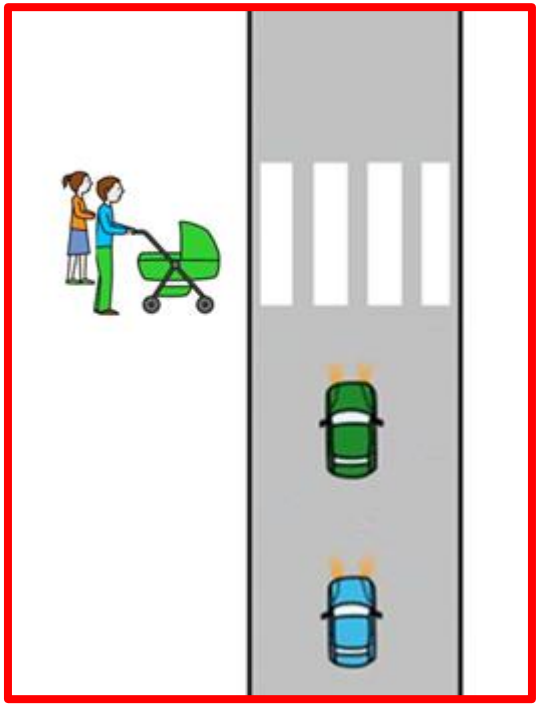

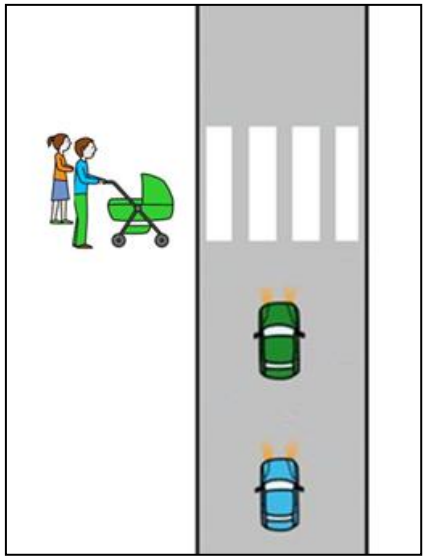

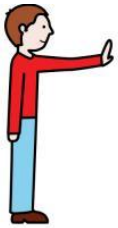

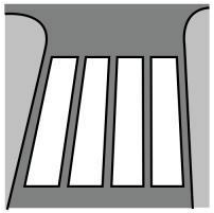

Los coches paran en el paso de peatones

¿ 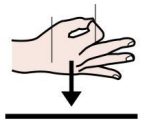

?

¿ Qué significan estas señales de tráfico?

Zona escolar



Obras

Paso de peatones

Hay

que cumplir

las normas

como peatones

Hay

que cumplir

las normas

en los medios de transporte